www.dynamicpapers.com

Please check the examination details below before entering your candidate infor on

Candidate surname	Other names

Centre Number | Candidate Number

Pearson Edexcel International GCSE

Time 2 hours

Paper reference **4PM1/01**

Further Pure Mathematics
PAPER 1



Calculators may be used.

Total Marks

Instructions

- Use **black** ink or ball-point pen.
- **Fill in the boxes** at the top of this page with your name, centre number and candidate number.
- Answer **all** questions.
- Without sufficient working, correct answers may be awarded no marks.
- Answer the questions in the spaces provided
  – *there may be more space than you need.*
- You must **NOT** write anything on the formulae page.
  Anything you write on the formulae page will gain NO credit.

Information

- The total mark for this paper is 100.
- The marks for **each** question are shown in brackets
  – *use this as a guide as to how much time to spend on each question.*

Advice

- Read each question carefully before you start to answer it.
- Check your answers if you have time at the end.

Turn over ▶

P71817A

©2023 Pearson Education Ltd.

J:1/1/1/

P 7 1 8 1 7 A 0 1 3 2

Pearson

www.dynamicpapers.com

International GCSE in Further Pure Mathematics Formulae sheet

Mensuration

Surface area of sphere = $4\pi r^2$

Curved surface area of cone = $\pi r \times$ slant height

Volume of sphere = $\frac{4}{3}\pi r^3$

Series

Arithmetic series

Sum to n terms, $S_n = \frac{n}{2}[2a + (n-1)d]$

Geometric series

Sum to n terms, $S_n = \frac{a(1-r^n)}{(1-r)}$

Sum to infinity, $S_\infty = \frac{a}{1-r} \quad |r| < 1$

Binomial series

$$(1+x)^n = 1 + nx + \frac{n(n-1)}{2!}x^2 + \ldots + \frac{n(n-1)\ldots(n-r+1)}{r!}x^r + \ldots \quad \text{for} \quad |x| < 1, n \in \mathbb{Q}$$

Calculus

Quotient rule (differentiation)

$$\frac{\mathrm{d}}{\mathrm{d}x}\left(\frac{\mathrm{f}(x)}{\mathrm{g}(x)}\right) = \frac{\mathrm{f}'(x)\mathrm{g}(x) - \mathrm{f}(x)\mathrm{g}'(x)}{[\mathrm{g}(x)]^2}$$

Trigonometry

Cosine rule

In triangle ABC: $a^2 = b^2 + c^2 - 2bc\cos A$

$\tan\theta = \frac{\sin\theta}{\cos\theta}$

$\sin(A+B) = \sin A \cos B + \cos A \sin B$ $\qquad$ $\sin(A-B) = \sin A \cos B - \cos A \sin B$

$\cos(A+B) = \cos A \cos B - \sin A \sin B$ $\qquad$ $\cos(A-B) = \cos A \cos B + \sin A \sin B$

$\tan(A+B) = \frac{\tan A + \tan B}{1 - \tan A \tan B}$ $\qquad$ $\tan(A-B) = \frac{\tan A - \tan B}{1 + \tan A \tan B}$

Logarithms

$\log_a x = \frac{\log_b x}{\log_b a}$

DO NOT WRITE IN THIS AREA
DO NOT WRITE IN THIS AREA
DO NOT WRITE IN THIS AREA

www.dynamicpapers.com

DO NOT WRITE IN THIS AREA
DO NOT WRITE IN THIS AREA
DO NOT WRITE IN THIS AREA

Answer all ELEVEN questions.

Write your answers in the spaces provided.

You must write down all the stages in your working.

1 The nth term of an arithmetic series is a_n where

$$a_{10} + a_{11} + a_{12} = 129 \quad \text{and} \quad a_{19} + a_{20} + a_{21} = 237$$

Find a_1

(4)

(Total for Question 1 is 4 marks)

www.dynamicpapers.com

2 The point A has coordinates $(-5, 3)$, the point B has coordinates $(4, 0)$ and the point has coordinates $(-1, 5)$.

The line l passes through C and is perpendicular to AB.

(a) Find an equation of l.
Give your answer in the form $ax + by + c = 0$ where a, b and c are integers.

(4)

The line l intersects AB at the point D.

(b) Show that the coordinates of D are $(-2, 2)$.

(3)

(c) Show that l is not the perpendicular bisector of AB.

(2)

(d) Find the value of $\tan \angle ABC$.
Give your answer in its simplest form.

(4)

DO NOT WRITE IN THIS AREA
DO NOT WRITE IN THIS AREA
DO NOT WRITE IN THIS AREA

www.dynamicpapers.com

DO NOT WRITE IN THIS AREA
DO NOT WRITE IN THIS AREA
DO NOT WRITE IN THIS AREA

Question 2 continued

www.dynamicpapers.com

Question 2 continued

DO NOT WRITE IN THIS AREA
DO NOT WRITE IN THIS AREA
DO NOT WRITE IN THIS AREA

www.dynamicpapers.com

DO NOT WRITE IN THIS AREA

DO NOT WRITE IN THIS AREA

DO NOT WRITE IN THIS AREA

Question 2 continued

(Total for Question 2 is 13 marks)

www.dynamicpapers.com

3 Curve C has equation $y = \dfrac{ax + 3}{1 - 2x}$ where $x \neq \dfrac{1}{2}$ and a is a constant.

The asymptote to C that is parallel to the x-axis has equation $y = 4$

(a) Find the value of a

(2)

(b) Write down the equation of the asymptote to C that is parallel to the y-axis.

(1)

(c) Find the coordinates of the point where C crosses

(i) the x-axis, (ii) the y-axis.

(2)

(d) Using the axes below, sketch C, showing clearly the asymptotes and the coordinates of the points where C crosses the coordinate axes.

(4)

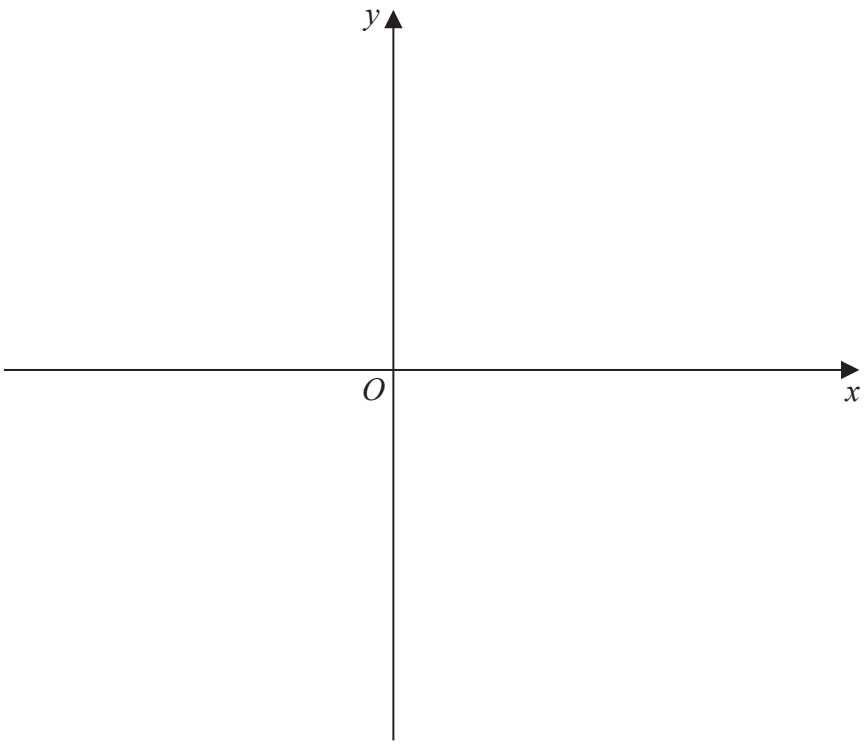

DO NOT WRITE IN THIS AREA
DO NOT WRITE IN THIS AREA
DO NOT WRITE IN THIS AREA

www.dynamicpapers.com

DO NOT WRITE IN THIS AREA

DO NOT WRITE IN THIS AREA

DO NOT WRITE IN THIS AREA

Question 3 continued

(Total for Question 3 is 9 marks)

www.dynamicpapers.com

4 $f(x) = x^3 + px^2 + qx + 6$ where p and q are constants.

Given that $(x - 1)$ is a factor of $f(x)$ and that when $f(x)$ is divided by $(x + 1)$ the remainder is 8

(a) (i) show that $p = -2$

(ii) find the value of q

(6)

(b) Hence, solve the equation $f(x) = 0$

(3)

DO NOT WRITE IN THIS AREA
DO NOT WRITE IN THIS AREA
DO NOT WRITE IN THIS AREA

www.dynamicpapers.com

DO NOT WRITE IN THIS AREA

DO NOT WRITE IN THIS AREA

DO NOT WRITE IN THIS AREA

Question 4 continued

(Total for Question 4 is 9 marks)

www.dynamicpapers.com

5 Given that k is a non-zero constant

curve C has equation $kx^2 - xy + (k + 1)x = 1$

straight line l has equation $y = \frac{k}{2}x + 1$

The point A is the only point that lies on both C and l.

(a) Find the value of k

(6)

(b) Hence, find the coordinates of A.

(2)

DO NOT WRITE IN THIS AREA
DO NOT WRITE IN THIS AREA
DO NOT WRITE IN THIS AREA

www.dynamicpapers.com

DO NOT WRITE IN THIS AREA

DO NOT WRITE IN THIS AREA

DO NOT WRITE IN THIS AREA

Question 5 continued

(Total for Question 5 is 8 marks)

www.dynamicpapers.com

6 Given that $(8 + 3x)^{\frac{1}{3}}$ can be expressed in the form $p(1 + qx)^{\frac{1}{3}}$ where p and q are constants,

(a) find the value of p and the value of q

(2)

(b) Hence, expand $(8 + 3x)^{\frac{1}{3}}$ in ascending powers of x up to and including the term in x^2, expressing each coefficient as an exact fraction in its lowest terms.

(3)

Using the expansion found in part (b) with a suitable value of x

(c) show that $\sqrt[3]{9} \approx \frac{599}{288}$

(2)

DO NOT WRITE IN THIS AREA
DO NOT WRITE IN THIS AREA
DO NOT WRITE IN THIS AREA

www.dynamicpapers.com

DO NOT WRITE IN THIS AREA

DO NOT WRITE IN THIS AREA

DO NOT WRITE IN THIS AREA

Question 6 continued

(Total for Question 6 is 7 marks)

www.dynamicpapers.com

7 (a) Complete the table of values for

$$y = 0.5^{\left(\frac{x}{3}+1\right)} + 2$$

giving each value to 2 decimal places where appropriate.

x	–6	–5	–4	–3	–2	–1	0
y	4	3.59	3.26				2.5

(2)

(b) On the grid opposite, draw the graph of $y = 0.5^{\left(\frac{x}{3}+1\right)} + 2$ for $-6 \leqslant x \leqslant 0$

(2)

(c) By drawing a suitable straight line on the grid, obtain an estimate, to one decimal place, of the root of the equation

$$\log_2(2x + 2)^3 + x + 3 = 0 \text{ in the interval } -6 \leqslant x \leqslant 0$$

(6)

DO NOT WRITE IN THIS AREA
DO NOT WRITE IN THIS AREA
DO NOT WRITE IN THIS AREA

www.dynamicpapers.com

DO NOT WRITE IN THIS AREA
DO NOT WRITE IN THIS AREA
DO NOT WRITE IN THIS AREA

Question 7 continued

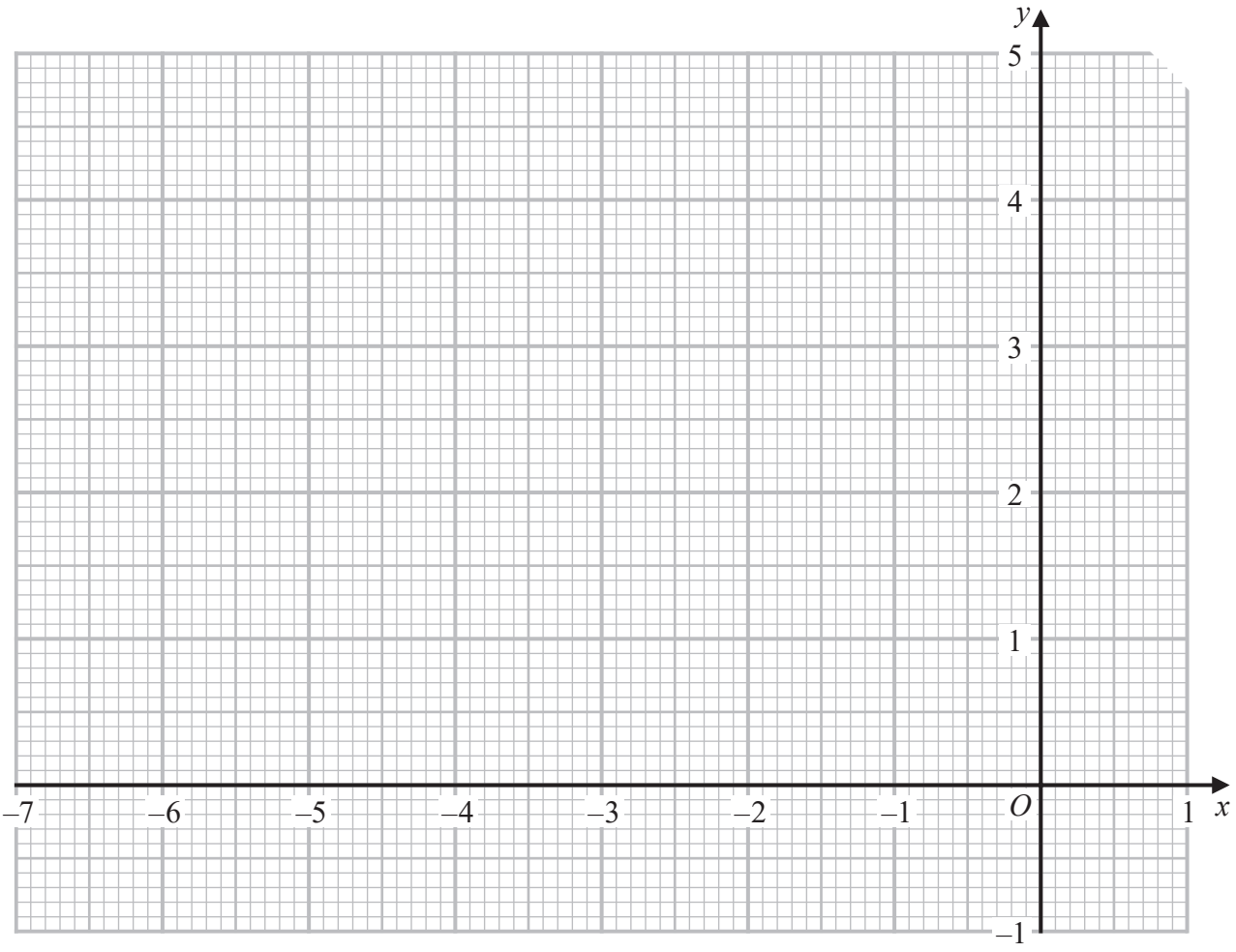

Turn over for a spare grid if you need to redraw your graph.

www.dynamicpapers.com

Question 7 continued

DO NOT WRITE IN THIS AREA
DO NOT WRITE IN THIS AREA
DO NOT WRITE IN THIS AREA

www.dynamicpapers.com

DO NOT WRITE IN THIS AREA
DO NOT WRITE IN THIS AREA
DO NOT WRITE IN THIS AREA

Question 7 continued

Only use this grid if you need to redraw your graph.

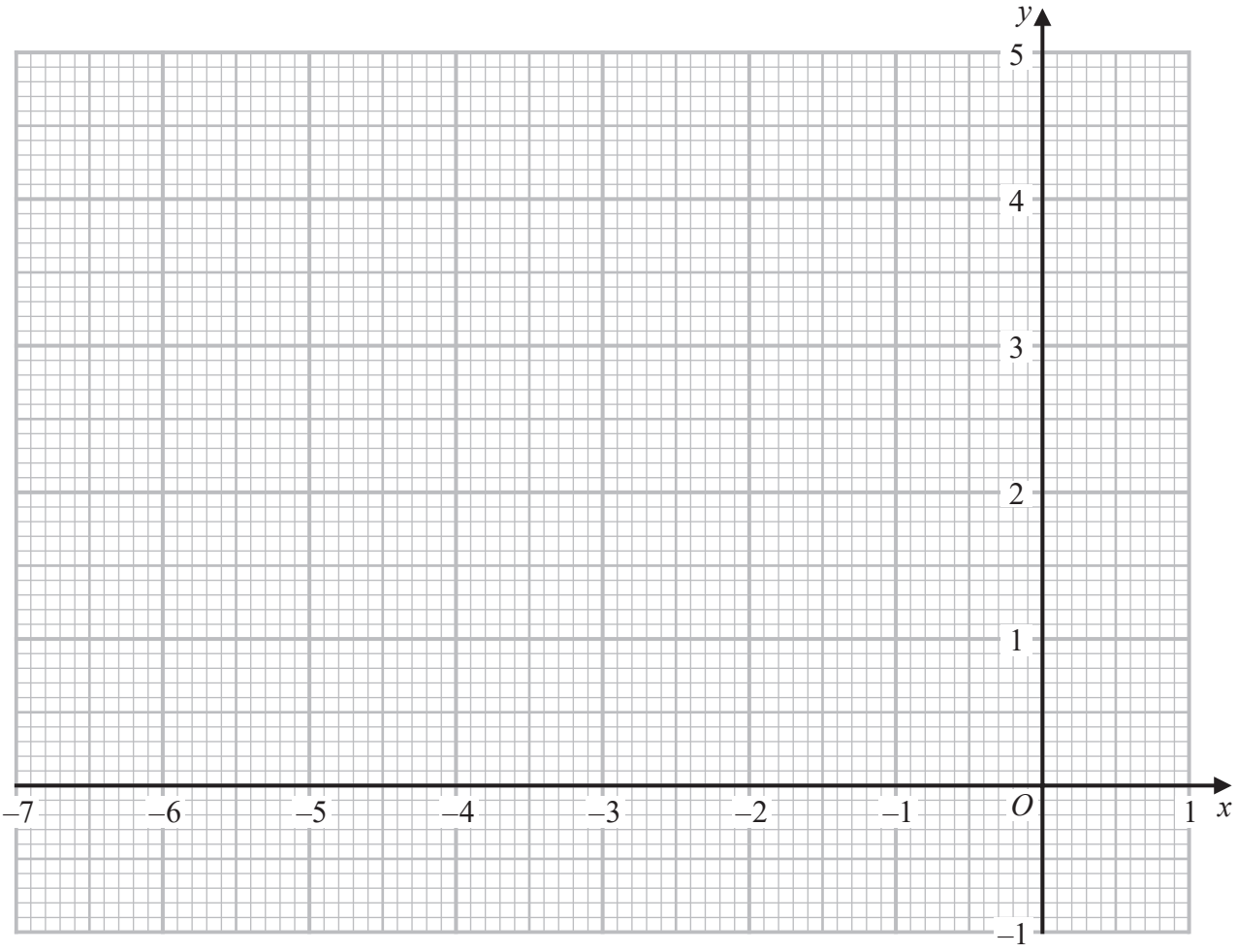

(Total for Question 7 is 10 marks)

www.dynamicpapers.com

8

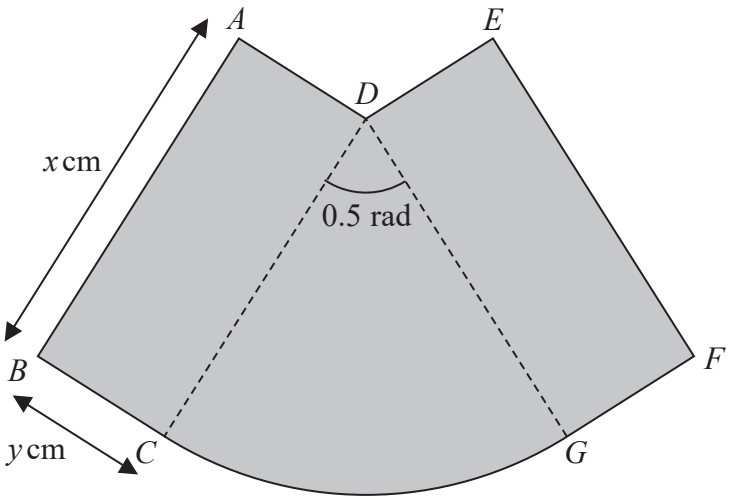

Diagram **NO** accurately draw

Figure 1

Figure 1 shows a badge, shown shaded, made from two identical rectangles, *ABCD* and *DEFG*, and a sector *DCG* of a circle with centre *D*.

Each rectangle measures x cm by y cm.
The radius of the sector is x cm and the angle *CDG* is 0.5 radians.

The area of the badge is 50 cm^2
The perimeter of the badge is P cm.

(a) Show that

$$P = 2x + \frac{100}{x}$$

(5)

Given that x can vary,

(b) use calculus, to find the exact value of x for which P is a minimum.
Justify that this value of x gives a minimum value for P

(6)

(c) Find the minimum value of P
Give your answer in the form $k\sqrt{2}$, where k is an integer to be found.

(2)

DO NOT WRITE IN THIS AREA
DO NOT WRITE IN THIS AREA
DO NOT WRITE IN THIS AREA

www.dynamicpapers.com

DO NOT WRITE IN THIS AREA
DO NOT WRITE IN THIS AREA
DO NOT WRITE IN THIS AREA

Question 8 continued

www.dynamicpapers.com

Question 8 continued

DO NOT WRITE IN THIS AREA
DO NOT WRITE IN THIS AREA
DO NOT WRITE IN THIS AREA

www.dynamicpapers.com

DO NOT WRITE IN THIS AREA

DO NOT WRITE IN THIS AREA

DO NOT WRITE IN THIS AREA

Question 8 continued

(Total for Question 8 is 13 marks)

www.dynamicpapers.com

9 Giving each value in your solution to 2 decimal places, solve the simultaneous equat

$$e^{2y} - x + 2 = 0$$

$$\ln(x + 3) - 2y - 1 = 0$$

(8)

DO NOT WRITE IN THIS AREA
DO NOT WRITE IN THIS AREA
DO NOT WRITE IN THIS AREA

www.dynamicpapers.com

DO NOT WRITE IN THIS AREA

DO NOT WRITE IN THIS AREA

DO NOT WRITE IN THIS AREA

Question 9 continued

(Total for Question 9 is 8 marks)

www.dynamicpapers.com

10

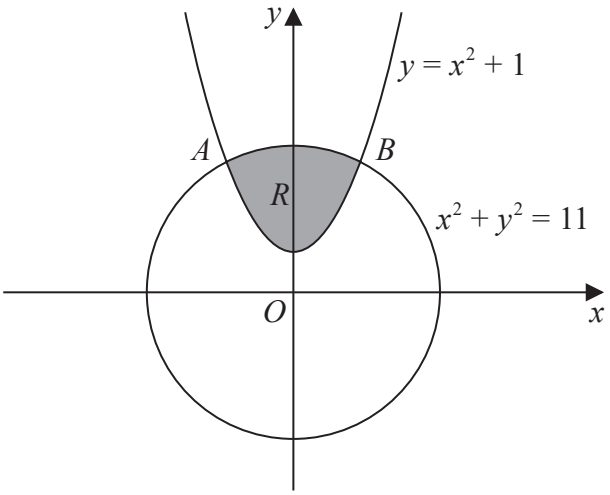

Diagram accurately d

Figure 2

The region R, shown shaded in Figure 2, is bounded by the curve with equation $y = x^2 + 1$ and the curve with equation $x^2 + y^2 = 11$

The two curves intersect at the point A and at the point B.

(a) Find the x coordinate of the point A and the x coordinate of the point B.

(4)

The region R is rotated through 360° about the x-axis.

(b) Use algebraic integration to find the volume, to 2 decimal places, of the solid generated.

(5)

DO NOT WRITE IN THIS AREA
DO NOT WRITE IN THIS AREA
DO NOT WRITE IN THIS AREA

www.dynamicpapers.com

Question 10 continued

DO NOT WRITE IN THIS AREA
DO NOT WRITE IN THIS AREA
DO NOT WRITE IN THIS AREA

www.dynamicpapers.com

Question 10 continued

DO NOT WRITE IN THIS AREA
DO NOT WRITE IN THIS AREA
DO NOT WRITE IN THIS AREA

www.dynamicpapers.com

DO NOT WRITE IN THIS AREA

DO NOT WRITE IN THIS AREA

DO NOT WRITE IN THIS AREA

Question 10 continued

(Total for Question 10 is 9 marks)

www.dynamicpapers.com

11

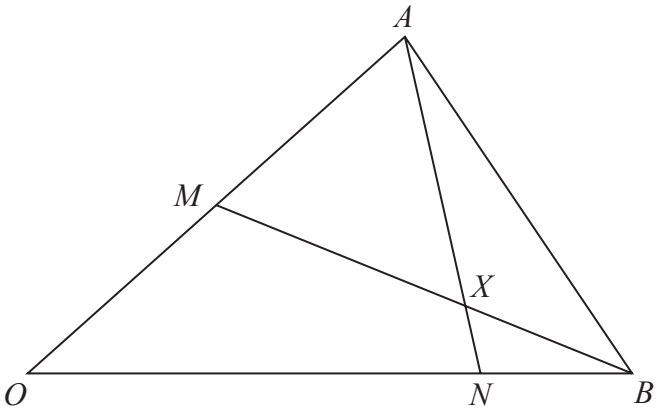

Diagram **N** accurately dra

Figure 3

Figure 3 shows triangle OAB with $\overrightarrow{OA} = \mathbf{a}$ and $\overrightarrow{OB} = \mathbf{b}$

M is the midpoint of OA.

N is the point on OB such that $ON : NB = 3 : 1$

The lines AN and BM intersect at the point X.

(a) Find expressions, in terms of **a** and **b**, for

(i) $\overrightarrow{AN}$ (ii) $\overrightarrow{BM}$

(3)

(b) Using a vector method, find $AX : XN$

(7)

DO NOT WRITE IN THIS AREA
DO NOT WRITE IN THIS AREA
DO NOT WRITE IN THIS AREA

www.dynamicpapers.com

DO NOT WRITE IN THIS AREA
DO NOT WRITE IN THIS AREA
DO NOT WRITE IN THIS AREA

Question 11 continued

www.dynamicpapers.com

Question 11 continued

(Total for Question 11 is 10 marks)

TOTAL FOR PAPER IS 100 MARKS

DO NOT WRITE IN THIS AREA
DO NOT WRITE IN THIS AREA
DO NOT WRITE IN THIS AREA