www.dynamicpapers.com

Please check the examination details below before entering your candidate information

Candidate surname	Other names

Pearson Edexcel International GCSE (9–1)

Centre Number | Candidate Number

Monday 20 January 2020

Afternoon (Time: 1 hour 15 minutes) | Paper Reference **4CH1/2CR**

Chemistry

Unit: 4CH1

Paper: 2CR

You must have:
Calculator, ruler

Total Marks

Instructions

- Use **black** ink or ball-point pen.
- **Fill in the boxes** at the top of this page with your name, centre number and candidate number.
- Answer **all** questions.
- Answer the questions in the spaces provided
  – *there may be more space than you need.*
- Show all the steps in any calculations and state the units.
- Some questions must be answered with a cross in a box ☒. If you change your mind about an answer, put a line through the box ☒ and then mark your new answer with a cross ☒.

Information

- The total mark for this paper is 70.
- The marks for **each** question are shown in brackets
  – *use this as a guide as to how much time to spend on each question.*

Advice

- Read each question carefully before you start to answer it.
- Write your answers neatly and in good English.
- Try to answer every question.
- Check your answers if you have time at the end.

Turn over ▶

P62061A

©2020 Pearson Education Ltd.

1/1/1/1/1/1/

P 6 2 0 6 1 A 0 1 2 4

Pearson

The Periodic Table of the Elements

1	2											3	4	5	6	7	0
							1 H hydrogen 1										4 He helium 2
7 Li lithium 3	9 Be beryllium 4											11 B boron 5	12 C carbon 6	14 N nitrogen 7	16 O oxygen 8	19 F fluorine 9	20 Ne neon 10
23 Na sodium 11	24 Mg magnesium 12											27 Al aluminium 13	28 Si silicon 14	31 P phosphorus 15	32 S sulfur 16	35.5 Cl chlorine 17	40 Ar argon 18
39 K potassium 19	40 Ca calcium 20	45 Sc scandium 21	48 Ti titanium 22	51 V vanadium 23	52 Cr chromium 24	55 Mn manganese 25	56 Fe iron 26	59 Co cobalt 27	59 Ni nickel 28	63.5 Cu copper 29	65 Zn zinc 30	70 Ga gallium 31	73 Ge germanium 32	75 As arsenic 33	79 Se selenium 34	80 Br bromine 35	84 Kr krypton 36
85 Rb rubidium 37	88 Sr strontium 38	89 Y yttrium 39	91 Zr zirconium 40	93 Nb niobium 41	96 Mo molybdenum 42	[98] Tc technetium 43	101 Ru ruthenium 44	103 Rh rhodium 45	106 Pd palladium 46	108 Ag silver 47	112 Cd cadmium 48	115 In indium 49	119 Sn tin 50	122 Sb antimony 51	128 Te tellurium 52	127 I iodine 53	131 Xe xenon 54
133 Cs caesium 55	137 Ba barium 56	139 La* lanthanum 57	178 Hf hafnium 72	181 Ta tantalum 73	184 W tungsten 74	186 Re rhenium 75	190 Os osmium 76	192 Ir iridium 77	195 Pt platinum 78	197 Au gold 79	201 Hg mercury 80	204 Tl thallium 81	207 Pb lead 82	209 Bi bismuth 83	[209] Po polonium 84	[210] At astatine 85	[222] Rn radon 86
[223] Fr francium 87	[226] Ra radium 88	[227] Ac* actinium 89	[261] Rf rutherfordium 104	[262] Db dubnium 105	[266] Sg seaborgium 106	[264] Bh bohrium 107	[277] Hs hassium 108	[268] Mt meitnerium 109	[271] Ds darmstadtium 110	[272] Rg roentgenium 111	Elements with atomic numbers 112-116 have been reported but not fully authenticated						

Key

relative atomic mass
atomic symbol
name
atomic (proton) number

**** The lanthanoids (atomic numbers 58-71) and the actinoids (atomic numbers 90-103) have been omitted.***

The relative atomic masses of copper and chlorine have not been rounded to the nearest whole number.

P 6 2 0 6 1 A 0 2 2 4

www.dynamicpapers.com

DO NOT WRITE IN THIS AREA DO NOT WRITE IN THIS AREA DO NOT WRITE IN THIS AREA

www.dynamicpapers.com

DO NOT WRITE IN THIS AREA
DO NOT WRITE IN THIS AREA
DO NOT WRITE IN THIS AREA

BLANK PAGE

www.dynamicpapers.com

Answer ALL questions.

1 Substances can be classified as elements, mixtures or compounds.

(a) Each box represents an element, a mixture or a compound.



Box 1 Box 2 Box 3 Box 4 Box 5

(i) Which box represents a mixture?

(1)

☒ **A** 1

☒ **B** 2

☒ **C** 3

☒ **D** 4

(ii) Which two boxes represent elements?

(1)

☒ **A** 1 and 2

☒ **B** 2 and 3

☒ **C** 1 and 3

☒ **D** 3 and 4

(iii) Explain why Box 5 represents a compound.

(2)

.....

.....

.....

.....

DO NOT WRITE IN THIS AREA
DO NOT WRITE IN THIS AREA
DO NOT WRITE IN THIS AREA

www.dynamicpapers.com

(b) The Periodic Table contains all the known elements.

(i) How are the elements arranged in the Periodic Table?

(1)

☒ **A** increasing mass number

☒ **B** increasing number of neutrons

☒ **C** increasing number of protons

☒ **D** increasing reactivity

(ii) Elements in the same group have the same number of

(1)

☒ **A** electrons in the outer shell

☒ **B** electron shells

☒ **C** neutrons

☒ **D** protons

(Total for Question 1 = 6 marks)

DO NOT WRITE IN THIS AREA
DO NOT WRITE IN THIS AREA
DO NOT WRITE IN THIS AREA

www.dynamicpapers.com

DO NOT WRITE IN THIS AREA

DO NOT WRITE IN THIS AREA

DO NOT WRITE IN THIS AREA

BLANK PAGE

www.dynamicpapers.com

DO NOT WRITE IN THIS AREA
DO NOT WRITE IN THIS AREA
DO NOT WRITE IN THIS AREA

2 Chromatography is used to analyse mixtures.

A student does a chromatography experiment to analyse the composition of green food colouring in sweets.

She places four known dyes, A, B, C and D, and the green food colouring on chromatography paper.

The diagram shows the student's apparatus at the start of her experiment.

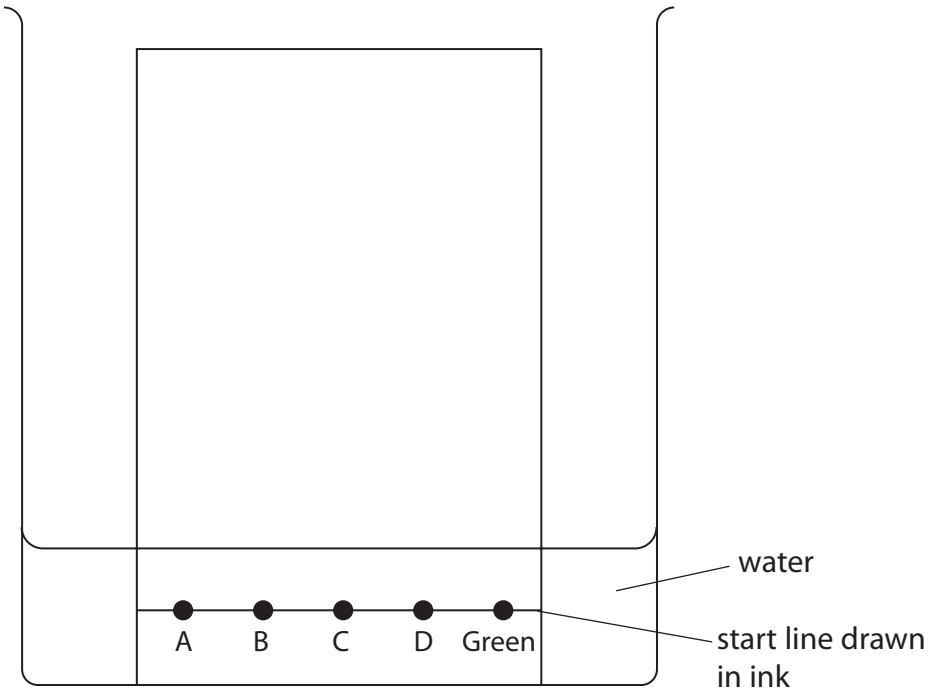

(a) The diagram shows that the student makes two mistakes when setting up her apparatus.

State the two changes that the student should make so that her experiment works.

(2)

1 .....

.....

2 .....

.....

www.dynamicpapers.com

(b) Another student does the chromatography experiment correctly.

The diagram shows her chromatogram at the end of the experiment.

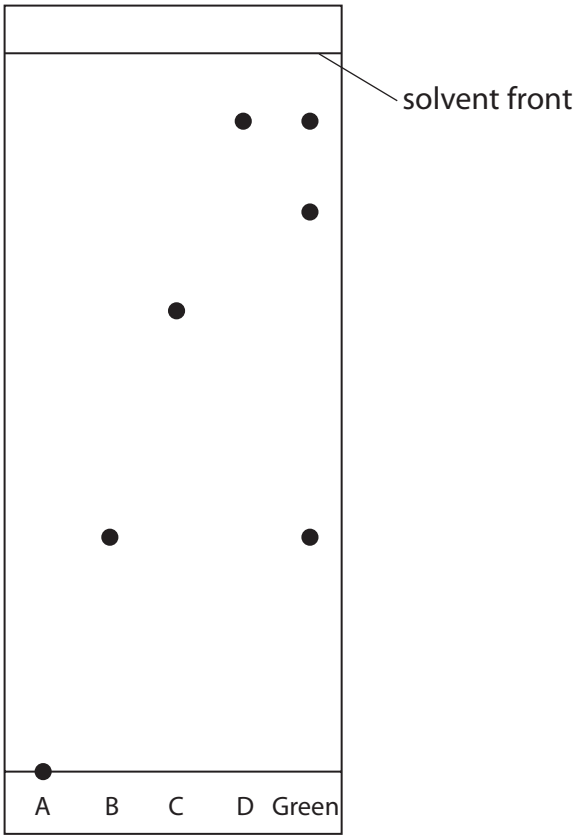

(i) Explain what the chromatogram shows about the composition of the green food colouring.

(3)

DO NOT WRITE IN THIS AREA
DO NOT WRITE IN THIS AREA
DO NOT WRITE IN THIS AREA

www.dynamicpapers.com

(ii) The distance between the start line and the spot for dye C is 6.2 cm.

Calculate the R_f value of dye C.

(3)

R_f value = ...

(iii) Suggest why dye A does not move.

(1)

.....

.....

(Total for Question 2 = 9 marks)

DO NOT WRITE IN THIS AREA
DO NOT WRITE IN THIS AREA
DO NOT WRITE IN THIS AREA

www.dynamicpapers.com

3 Solutions of silver nitrate and potassium chloride react together to make the insoluble salt, silver chloride.

A student uses this method to prepare a sample of silver chloride.

Step 1 add 25 cm^3 of silver nitrate solution to a conical flask

Step 2 add potassium chloride solution to the flask

Step 3 filter off the silver chloride

(a) What term is used for this reaction?

(1)

☒ **A** neutralisation

☒ **B** precipitation

☒ **C** redox

☒ **D** thermal decomposition

(b) Give two more steps that will produce a pure, dry sample of silver chloride.

(2)

Step 4 .....

.....

Step 5 .....

.....

(c) Acidified silver nitrate solution is used to test for chloride ions.

Give a reason why hydrochloric acid is not used to acidify silver nitrate solution.

(1)

.....

.....

.....

DO NOT WRITE IN THIS AREA
DO NOT WRITE IN THIS AREA
DO NOT WRITE IN THIS AREA

www.dynamicpapers.com

DO NOT WRITE IN THIS AREA
DO NOT WRITE IN THIS AREA
DO NOT WRITE IN THIS AREA

(d) The chemical equation for the reaction between solutions of silver nitrate and potassium chloride is

$$AgNO_3(aq) + KCl(aq) \rightarrow AgCl(s) + KNO_3(aq)$$

A student adds an excess of potassium chloride solution to 25.0 cm^3 of 0.100 mol/dm^3 silver nitrate solution.

Calculate the maximum mass of silver chloride, in grams, that can be produced.

[M_r of AgCl = 143.5]

(2)

mass = ... g

(Total for Question 3 = 6 marks)

www.dynamicpapers.com

4 This question is about the metal, lead.

(a) Explain why metals, such as lead, are malleable.

(2)

(b) A teacher uses this apparatus in a fume cupboard to demonstrate the electrolysis of lead(II) bromide.

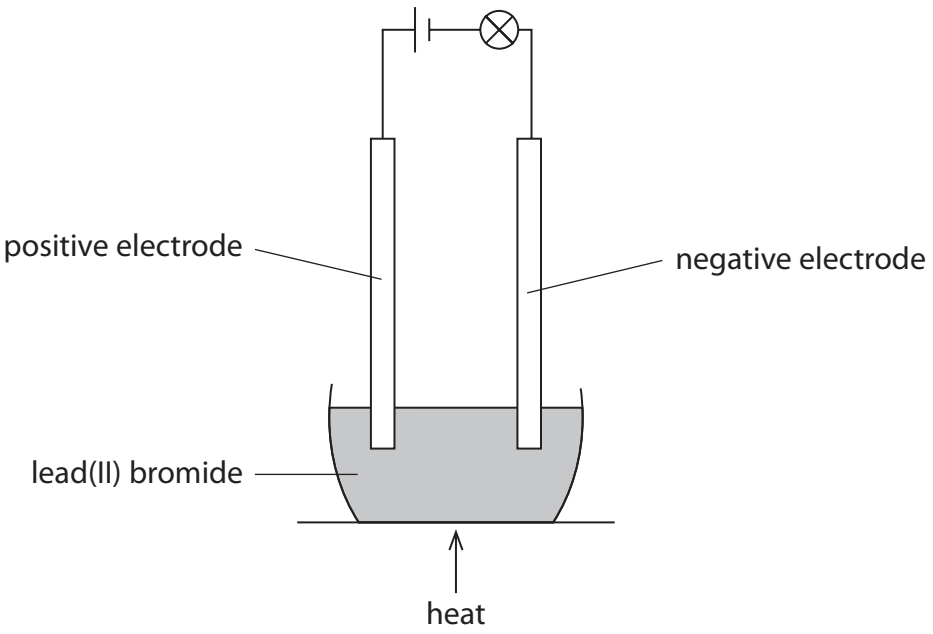

The lead(II) bromide is heated until it melts.

When the lead(II) bromide melts, the lamp lights.

One of the products of this electrolysis is lead.

(i) State why solid lead(II) bromide does not conduct electricity.

(1)

DO NOT WRITE IN THIS AREA
DO NOT WRITE IN THIS AREA
DO NOT WRITE IN THIS AREA

www.dynamicpapers.com

(ii) Bromine is formed by the oxidation of bromide ions at the positive electrode.

Complete the ionic half-equation for the oxidation of bromide ions.

(1)

$2Br^- \rightarrow$ ..... + ...

(iii) Explain why lead metal forms at the negative electrode.

(2)

.....

.....

.....

.....

(iv) The teacher stops heating the mixture and allows it to solidify.

Suggest why the lamp stays alight.

(1)

.....

.....

.....

(Total for Question 4 = 7 marks)

DO NOT WRITE IN THIS AREA
DO NOT WRITE IN THIS AREA
DO NOT WRITE IN THIS AREA

www.dynamicpapers.com

5 This question is about Group 1 metals and their reactions.

(a) When lithium is added to water, bubbles of hydrogen gas are observed.

(i) Give two other observations that could be made.

(2)

1 .....

.....

2 .....

.....

(ii) Give the test for hydrogen gas.

(1)

.....

.....

(b) (i) Give one observation that would be different if potassium is used instead of lithium.

(1)

.....

.....

DO NOT WRITE IN THIS AREA
DO NOT WRITE IN THIS AREA
DO NOT WRITE IN THIS AREA

www.dynamicpapers.com

(ii) The diagram represents an atom of lithium and an atom of potassium.

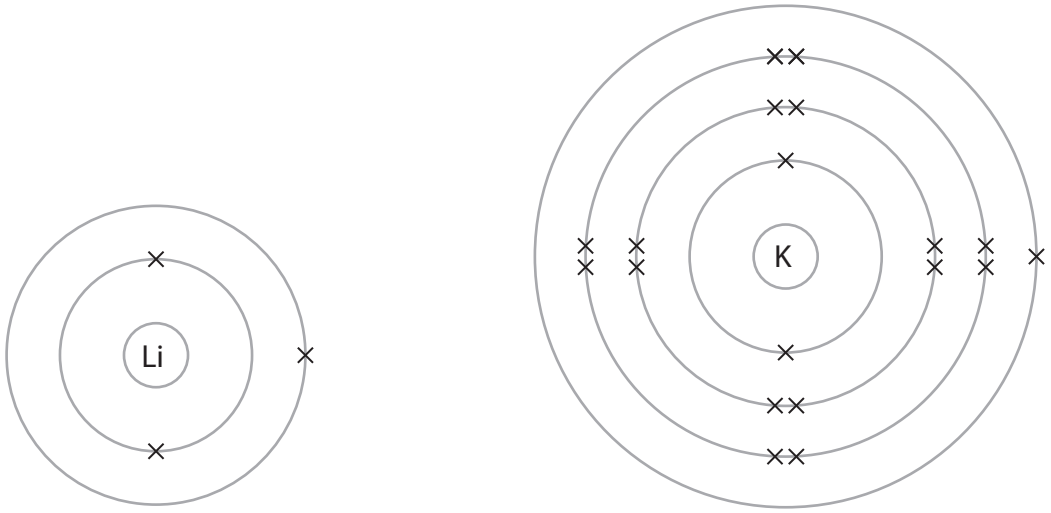

Explain why potassium is more reactive than lithium.

(3)

DO NOT WRITE IN THIS AREA
DO NOT WRITE IN THIS AREA
DO NOT WRITE IN THIS AREA

www.dynamicpapers.com

(c) The equation for the reaction between lithium and water is

$$2Li(s) + 2H_2O(l) \rightarrow 2LiOH(aq) + H_2(g)$$

(i) A mass of 0.500 g of lithium reacts with an excess of water.

Calculate the volume, in cm^3, of hydrogen gas produced at rtp.

[molar volume of a gas at rtp = 24 000 cm^3]

Give your answer to three significant figures.

(3)

volume = ... cm^3

(ii) In a reaction between lithium and water, 150 cm^3 of lithium hydroxide solution is formed.

The lithium hydroxide solution is then completely neutralised by 24.85 cm^3 of 0.100 mol/dm^3 sulfuric acid.

The equation for the neutralisation is

$$2LiOH(aq) + H_2SO_4(aq) \rightarrow Li_2SO_4(aq) + 2H_2O(l)$$

Calculate the concentration, in mol/dm^3, of the lithium hydroxide solution.

(3)

concentration = ... mol/dm^3

(Total for Question 5 = 13 marks)

DO NOT WRITE IN THIS AREA
DO NOT WRITE IN THIS AREA
DO NOT WRITE IN THIS AREA

www.dynamicpapers.com

DO NOT WRITE IN THIS AREA
DO NOT WRITE IN THIS AREA
DO NOT WRITE IN THIS AREA

BLANK PAGE

www.dynamicpapers.com

6 This question is about ethane and ethene.

(a) Ethane can be obtained from crude oil.

Describe the industrial process used to separate crude oil into fractions.

(4)

(b) The equation for the reaction between ethene gas and hydrogen gas is

$$C_2H_4 + H_2 \rightarrow C_2H_6$$

The rate of this reaction can be increased by increasing the pressure.

(i) Explain why increasing the pressure increases the rate of this reaction.

(2)

DO NOT WRITE IN THIS AREA
DO NOT WRITE IN THIS AREA
DO NOT WRITE IN THIS AREA

www.dynamicpapers.com

DO NOT WRITE IN THIS AREA

DO NOT WRITE IN THIS AREA

DO NOT WRITE IN THIS AREA

(ii) The rate of this reaction can also be increased by using a catalyst.

Explain how using a catalyst increases the rate of a reaction.

(2)

.....

.....

.....

.....

(iii) Give one other way that the rate of reaction between ethene gas and hydrogen gas can be increased.

(1)

.....

.....

(iv) The reaction between ethene and hydrogen is exothermic.

Complete the reaction profile diagram, including labels for the activation energy and the enthalpy change, ΔH.

(3)

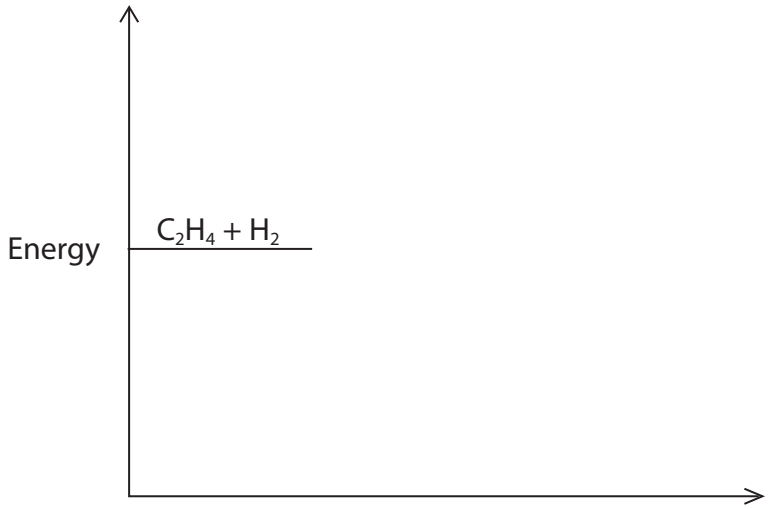

www.dynamicpapers.com

(c) The reaction between ethene and hydrogen can be represented using displayed formulae.

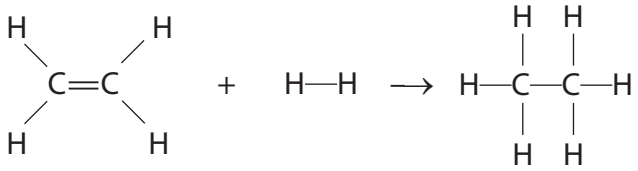

Bond	Bond energy in kJ/mol
C=C	612
C—H	412
H—H	436
C—C	348

Use the bond energies in the table to calculate the enthalpy change, ΔH, in kJ/mol for this reaction.

(3)

$\Delta H =$ ..... kJ/mol

(Total for Question 6 = 15 marks)

DO NOT WRITE IN THIS AREA
DO NOT WRITE IN THIS AREA
DO NOT WRITE IN THIS AREA

www.dynamicpapers.com

7 (a) Ethanol, C_2H_5OH, can be produced by the fermentation of glucose, $C_6H_{12}O_6$

(i) Complete the equation for the fermentation of glucose.

(1)

$$C_6H_{12}O_6 \rightarrow 2C_2H_5OH + 2 \text{ .....}$$

(ii) State why it is necessary for fermentation to be done in the absence of air.

(1)

.....

.....

(iii) Explain why the temperature should not be higher than 40 °C.

(2)

.....

.....

.....

.....

(iv) When 4 mol of glucose is fermented, a mass of 55.2 g of ethanol is produced.

Show that the percentage yield of ethanol is 15%.

[M_r of C_2H_5OH = 46]

(2)

DO NOT WRITE IN THIS AREA
DO NOT WRITE IN THIS AREA
DO NOT WRITE IN THIS AREA

www.dynamicpapers.com

(b) Ethanol can also be produced by the reaction between ethene and steam.

The equation for the reaction is

$$C_2H_4(g) + H_2O(g) \rightleftharpoons C_2H_5OH(g)$$

(i) This reaction is in dynamic equilibrium.

Give two features of a reaction in dynamic equilibrium.

(2)

1 .....

.....

2 .....

.....

(ii) When the equilibrium mixture is heated, the yield of ethanol decreases.

Explain whether the forward reaction is exothermic or endothermic.

(2)

.....

.....

.....

.....

.....

.....

DO NOT WRITE IN THIS AREA
DO NOT WRITE IN THIS AREA
DO NOT WRITE IN THIS AREA

www.dynamicpapers.com

DO NOT WRITE IN THIS AREA
DO NOT WRITE IN THIS AREA
DO NOT WRITE IN THIS AREA

(c) Carboxylic acids react with alcohols to form esters.

The displayed formula of an ester is

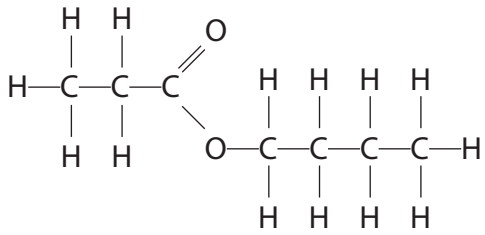

(i) Carboxylic acid A and alcohol B react to produce this ester.

Give the displayed formula of carboxylic acid A and of alcohol B.

(2)

Carboxylic acid A	Alcohol B

(ii) Indicators can be used to test for carboxylic acids.

Describe a different chemical test for a carboxylic acid.

(2)

.....

.....

.....

.....

(Total for Question 7 = 14 marks)

TOTAL FOR PAPER = 70 MARKS

www.dynamicpapers.com

DO NOT WRITE IN THIS AREA

DO NOT WRITE IN THIS AREA

DO NOT WRITE IN THIS AREA

BLANK PAGE